Name: _____

Exercise 4C Question 1

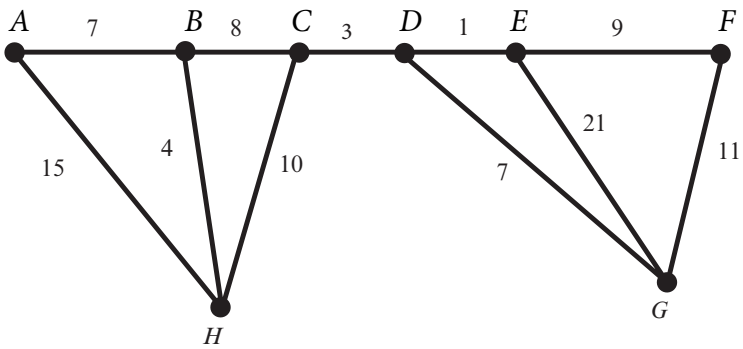

(Total weight of network is 96)

© Pearson Education Ltd 2017. Copying permitted for purchasing institution only. This material is not copyright free.

Name: _____

Exercise 4C Question 2

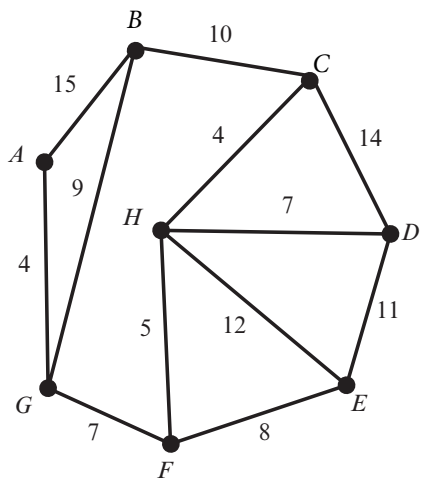

(Total weight of network is 106)

© Pearson Education Ltd 2017. Copying permitted for purchasing institution only. This material is not copyright free.

Name: _____

Exercise 4C Question 3

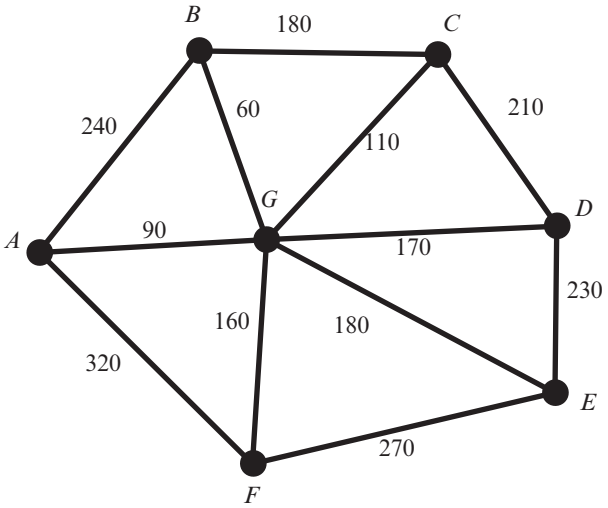

(Total weight of network is 2220)

© Pearson Education Ltd 2017. Copying permitted for purchasing institution only. This material is not copyright free.

Name: _____

Exercise 4C Question 4

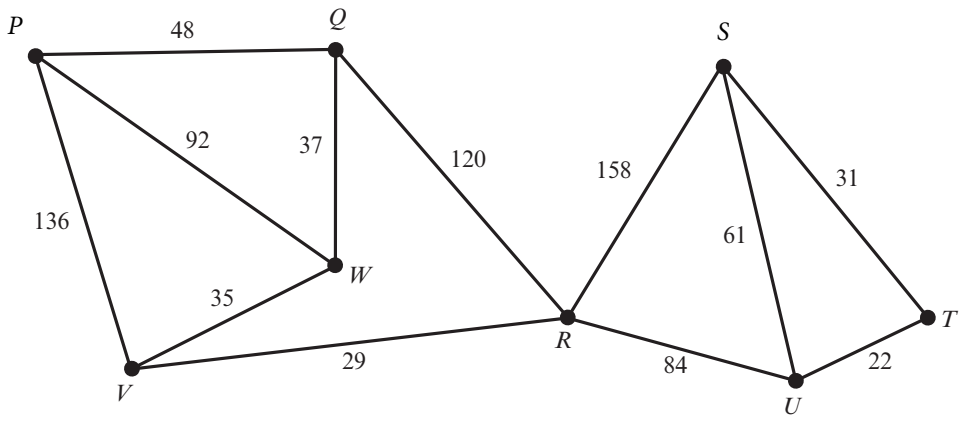

(Total weight of network is 853)

© Pearson Education Ltd 2017. Copying permitted for purchasing institution only. This material is not copyright free.