Name: _____

Mixed exercise 4 Question 4

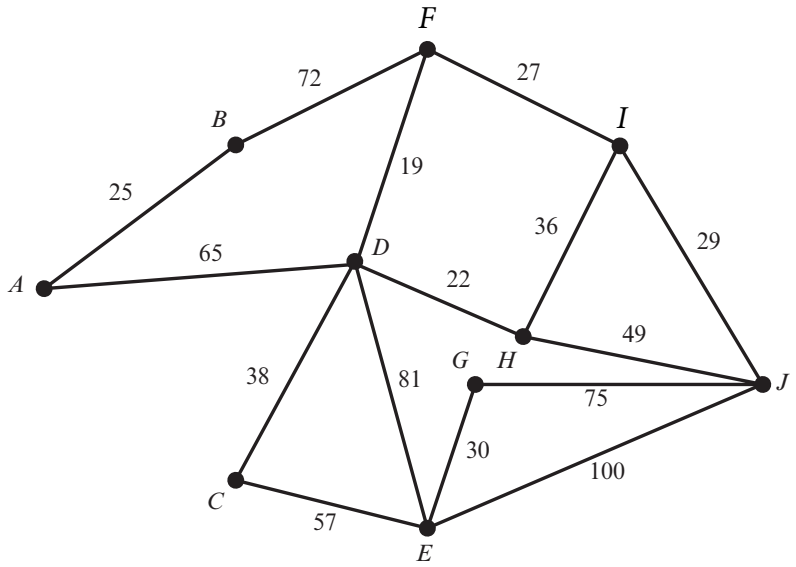

(Total weight of network is 725)

© Pearson Education Ltd 2017. Copying permitted for purchasing institution only. This material is not copyright free.

Name: _____

Mixed exercise 4 Question 5

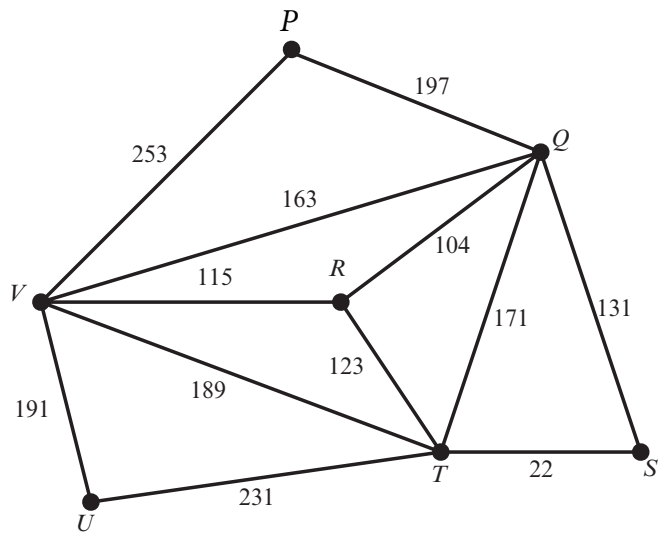

(Total weight of network is 1890)

© Pearson Education Ltd 2017. Copying permitted for purchasing institution only. This material is not copyright free.

Name: _____

Mixed exercise 4 Question 6

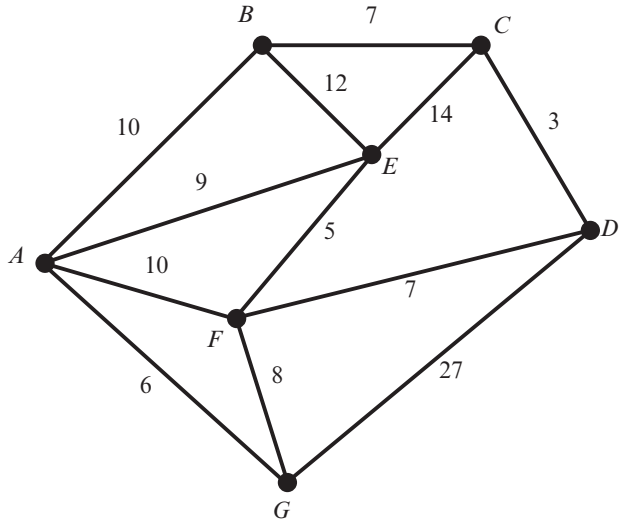

(Total weight of network is 118)

© Pearson Education Ltd 2017. Copying permitted for purchasing institution only. This material is not copyright free.

Name: _____

Mixed exercise 4 Question 7

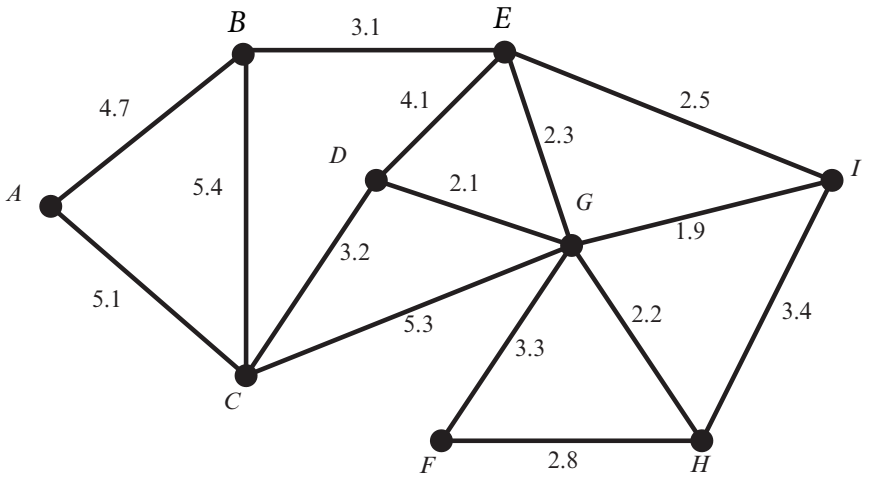

(Total weight of network is 51.4)

© Pearson Education Ltd 2017. Copying permitted for purchasing institution only. This material is not copyright free.

Name: _____

Mixed exercise 4 Question 8

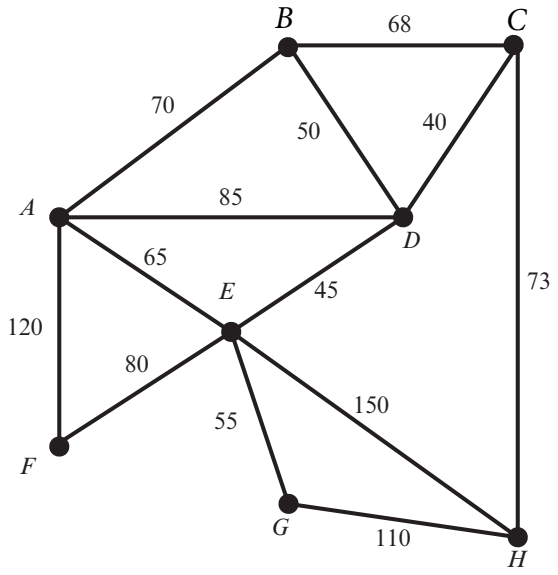

(Total weight of network is 1011)

© Pearson Education Ltd 2017. Copying permitted for purchasing institution only. This material is not copyright free.

Name: _____

Mixed exercise 4 Question 9

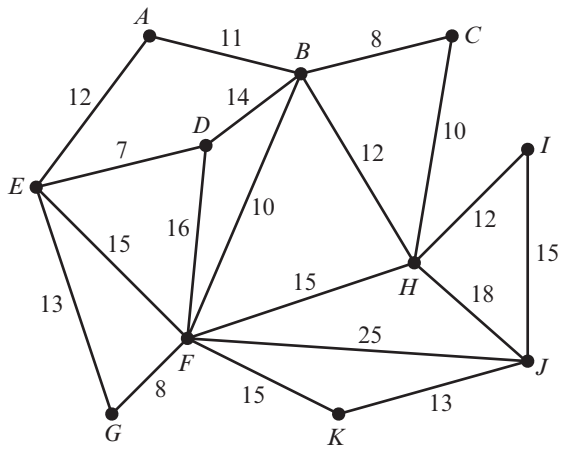

(Total weight of network is 249)

© Pearson Education Ltd 2017. Copying permitted for purchasing institution only. This material is not copyright free.

Name: _____

Mixed exercise 4 Question 10

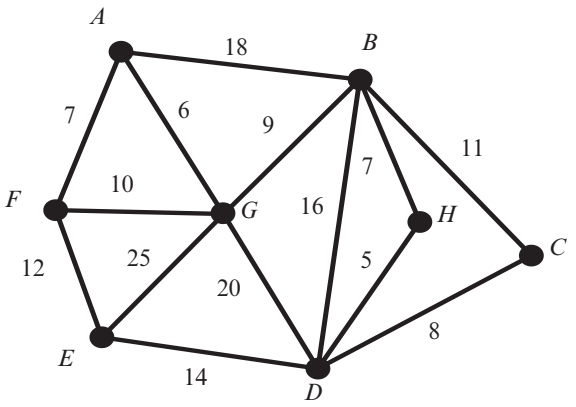

(Total weight of network is 168)

© Pearson Education Ltd 2017. Copying permitted for purchasing institution only. This material is not copyright free.

Name: _____

Mixed exercise 4 Challenge

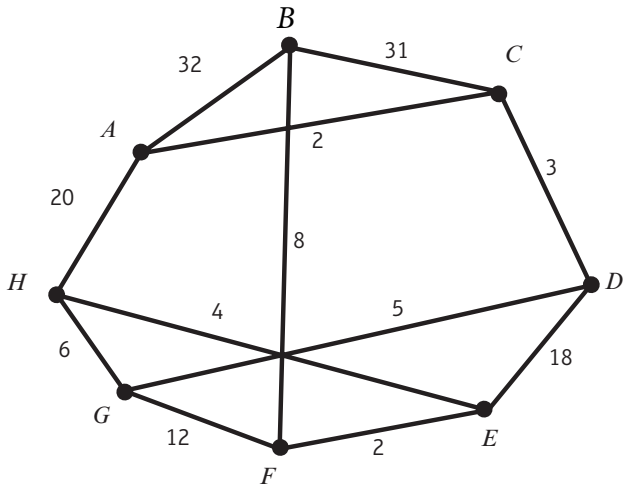

(Total weight of network is 143)

© Pearson Education Ltd 2017. Copying permitted for purchasing institution only. This material is not copyright free.